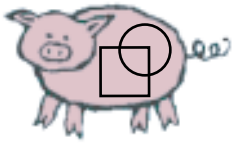

Is it a Polygon?

* Golf green #1 is a

What is it? _____

Is it a polygon? _____

How many sides does it have? _____

How many angles? _____

* Golf green #2 is a 

What is it? _____

Is it a polygon? _____

How many sides does it have? _____

How many angles? _____

* Golf green #3 is a 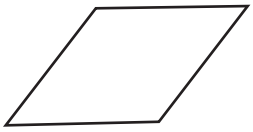

What is it? _____

Is it a polygon? _____

How many sides does it have? _____

How many angles? _____

igsontheballpigsontheballpigsontheballpigsontheballpigsontheballpigsontheballpigsontheballpigsontheballpigsontheba