What time is it?

Mr. Pig was ready for the beach at 12:30. Draw the hands on the clock to show forty-five minutes later. What time is it?

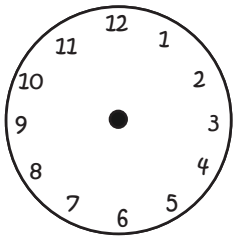

_____:_____

The Pigs arrived at the beach at 3:30. Draw the hands on the clock to show twenty minutes earlier. What time is it?

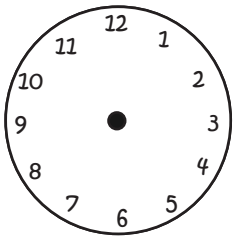

_____:_____

The Pigs began digesting their food at 4:40. Draw the hands on the clock to show three hours and twenty minutes later. What time is it?

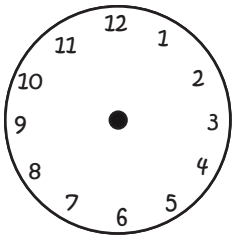

_____:_____

The beach closed at 5:30. Draw the hands on the clock to show two and a half hour earlier. What time is it?

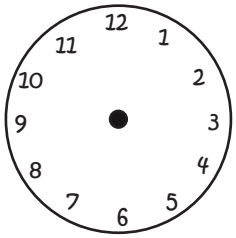

_____:_____

pigsonablanketpigsonablanketpigsonablanketpigsonablanketpigsonablanketpigsonablanketpigsonablanketpigsonablan